Fractions Made Fun Series

What Is a Fraction?

Parts of a whole and parts of a set

BOOKLET 1

Grades 3 – 5

Ages 8 – 11

What will you learn?

- Numerator and denominator
- Equal parts of a whole
- Coloring and writing fractions
- Reading fractions in words
- Fractions of a set
- Problems and number lines

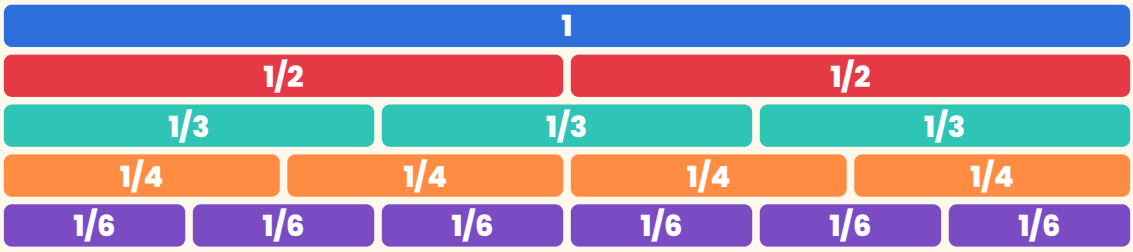

Printable

4 worksheets + answer key

Home or classroom

Fractions Made Fun

aresolutions.es

Name: _____ Date: _____

A **fraction** shows **equal** parts of a whole.
The **numerator** (top) tells how many parts we take.
The **denominator** (bottom) tells how many equal parts the whole is divided into.

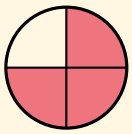

$\frac{3}{4}$

1

Write the fraction for the shaded part.

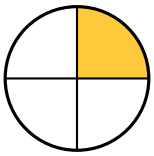

$\frac{\square}{\square}$

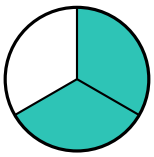

$\frac{\square}{\square}$

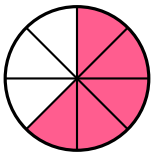

$\frac{\square}{\square}$

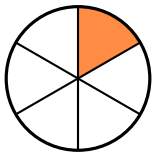

$\frac{\square}{\square}$



$\frac{\square}{\square}$



$\frac{\square}{\square}$

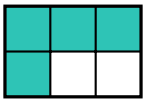

$\frac{\square}{\square}$

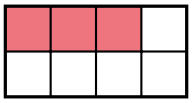

$\frac{\square}{\square}$

2

Is the shape divided into equal parts? Mark Yes or No.

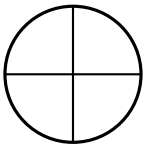

○ Yes ○ No

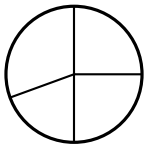

○ Yes ○ No



○ Yes ○ No

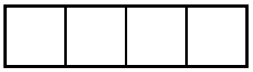

○ Yes ○ No

3

Divide each shape into the number of equal parts shown. Then shade one part.



2 equal parts



4 equal parts



4 equal parts

© 2026 Fractions Made Fun · aresolutions.es · Personal and classroom use only. Do not resell.

Name: _____ Date: _____

4

Shade the fraction shown under each shape.

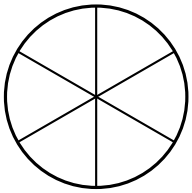

$\frac{5}{6}$

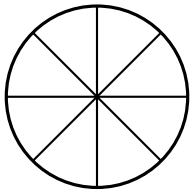

$\frac{3}{8}$

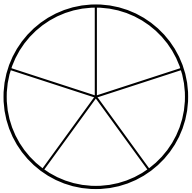

$\frac{4}{5}$



$\frac{2}{3}$

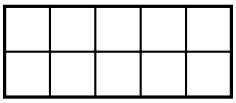

$\frac{7}{10}$

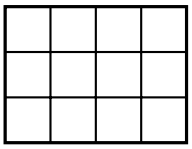

$\frac{5}{12}$

5

Complete the table. Write each fraction in words or in numbers.

Number	In words	Number	In words
$\frac{1}{2}$	one half	$\frac{\square}{\square}$	two thirds
$\frac{3}{4}$		$\frac{\square}{\square}$	five sixths
$\frac{4}{7}$		$\frac{\square}{\square}$	one ninth
$\frac{3}{10}$		$\frac{\square}{\square}$	seven eighths
$\frac{5}{9}$		$\frac{\square}{\square}$	one quarter

© 2026 Fractions Made Fun · aresolutions.es · Personal and classroom use only. Do not resell.